Find the missing number

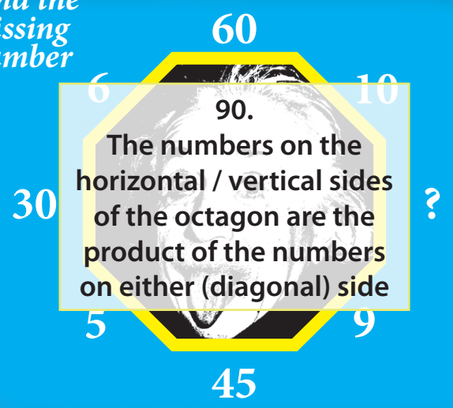

90.
The numbers on the horizontal / vertical sides of the octagon are the product of the numbers on either (diagonal) side

This five-letter word becomes shorter when you add two letters to it.

What is the word?

Short

what's the largest three-digit number you can make

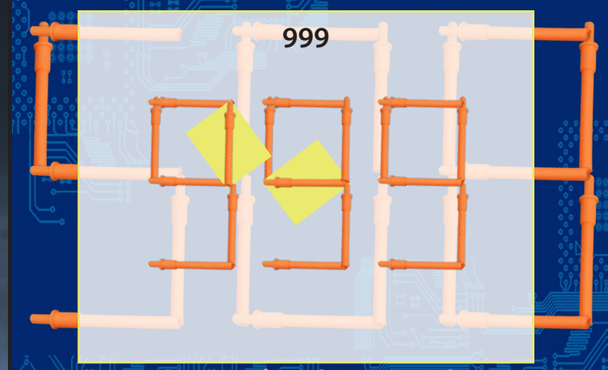

by moving ONLY TWO dummy contact sealing plugs?

If...

123 = 18
233 = 2
133 = 2
532 = 20

then 142 = ?

14.
For each number, add the three digits, then multiply the sum by the third number (e.g. 1+2+3 = 6, X 3 = 18)

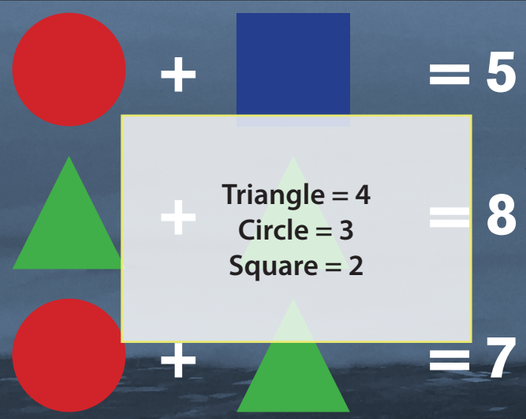

Triangle = 4
Circle = 3
Square = 2

what are the number values for each shape?

Find the mistake...

BBBB DDDD FFFF
HHHH JJJJ LLLL
NNNN PPPP RRRR
TTTT UUUU
XXXX ZZZZ

UUUU.
The letters alternate (a B c D e F...) until you get to U

We got 6:
Elephant, Horse
Dog, Cat, Rat
Gorilla

Which tank will fill up first?

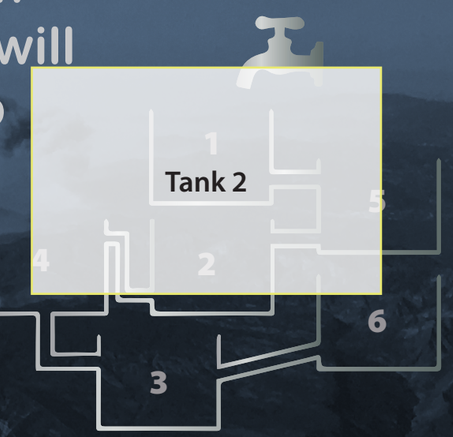

Tank 2

WHAT ARE THE NUMBERS OF THE PARKING SPACES WITH AIRPLANES IN THEM?

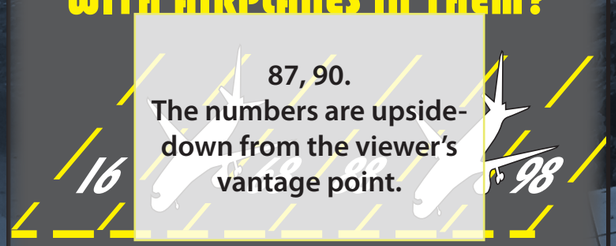

87, 90.
The numbers are upside-down from the viewer's vantage point.

Which of the numbers are reversed?

One continuous piece

Two separate pieces

One of the spirals is made from one continuous rope, joined at the ends.
The other is made from two separate pieces.
Which is which?

Solve the puzzle. A, B, C, or D?

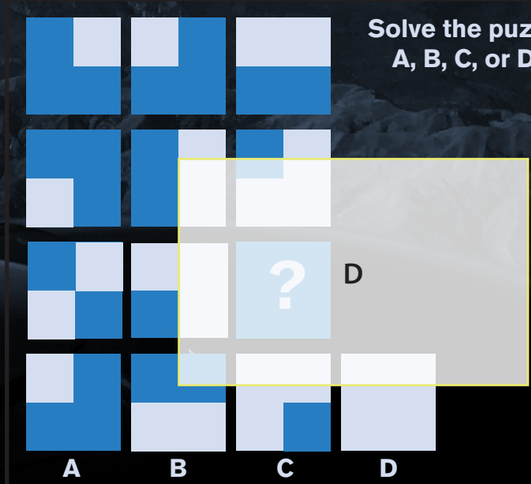

D